EYES

Bonus Puzzle • Page 1 of 1

The patient is seeing double! Instead of showing the same image, each eye is altering the image. Fill in the first two grids below to reveal the images seen by the eyes, then identify the places where the eyes differ to discover the solution to this problem.

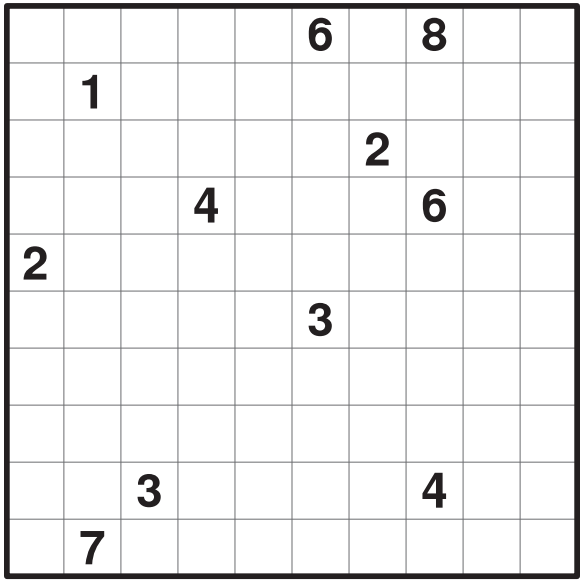

- Shade cells to create white regions.
- Each white region must contain exactly one number, which specifies how many cells are in the region.
- All black cells must connect.
- No 2×2 area may be all black.

Example

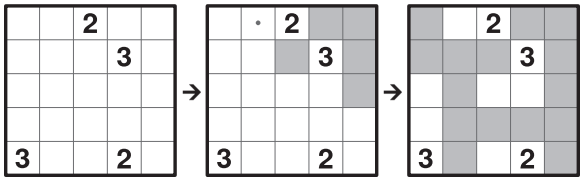

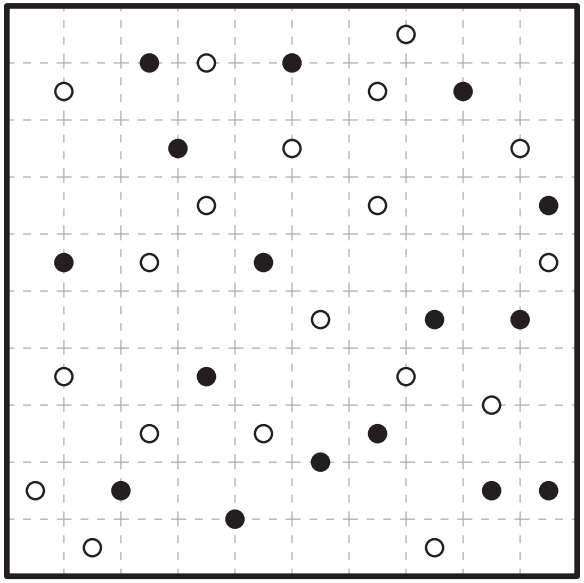

- Divide the grid into regions along gridlines.
- Each region must contain exactly one circle, and have 180° rotational symmetry around its circle.
- Shade all regions with black circles.

Example

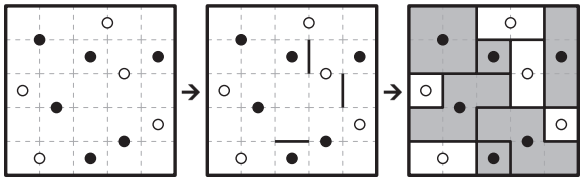



You can use this grid to correlate the images from the eyes.